Minus – Aufgaben bis 20

<u>Aufgabe:</u> Schreibe zu jedem Bild eine Minus – Aufgabe in die Kästchen!




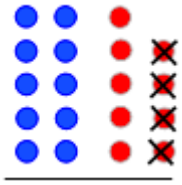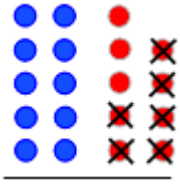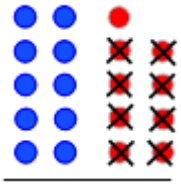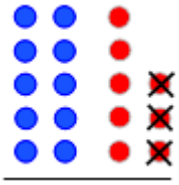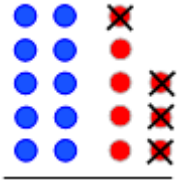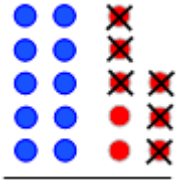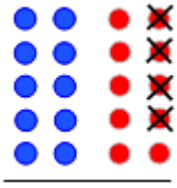
1	5	–	2	=