Plus – Aufgaben bis 20

<u>Aufgabe:</u> Schreibe zu jedem Bild eine Plus – Aufgabe in die Kästchen!






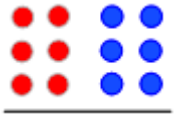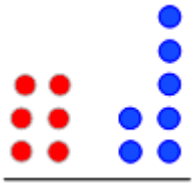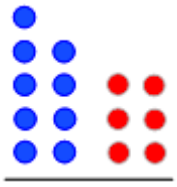
8 + 4 =